Salles taillées dans le rocher du Musée et connues sous le nom de Prison de Socrate.



c niche au fond de la chambre du milieu.

d trou entre la chambre du milieu et celle de droite.



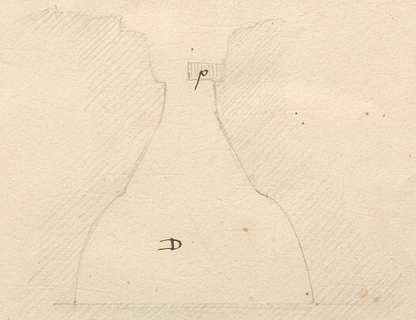

coupe vertical de la chambre b i

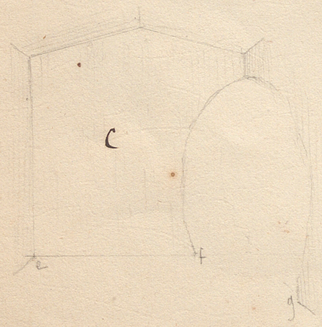

Elévation de la paroi e f
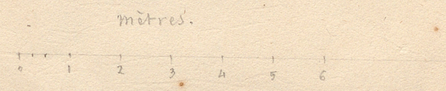
porte f g